Rewriting Multiplication Problems (visual)

Name:

Write each array as a multiplication problem and solve.

Ex)



1)

2)

3)



4)

5)

6)

7)

8)



9)

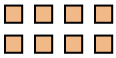

10)



11)



Answers

Ex. 8 × 5 = 40

1. _____
2. _____
3. _____
4. _____
5. _____
6. _____
7. _____
8. _____
9. _____
10. _____
11. _____

1-10	91	82	73	64	55	45	36	27	18	9
11	0									

Rewriting Multiplication Problems (visual) Name: **Answer Key**

Write each array as a multiplication problem and solve.

Ex) 

1)

2)

3) 

4)

5)

6)

7)

8) 

9) 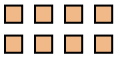

10) 

11) 

Answers

Ex. 8 × 5 = 40

1. 9 × 3 = 27
2. 4 × 5 = 20
3. 5 × 8 = 40
4. 10 × 2 = 20
5. 5 × 6 = 30
6. 9 × 5 = 45
7. 8 × 2 = 16
8. 10 × 7 = 70
9. 2 × 4 = 8
10. 4 × 10 = 40
11. 3 × 4 = 12

1-10	91	82	73	64	55	45	36	27	18	9
11	0									